All rights reserved. No part of this publication may be reproduced, distributed, or transmitted in any form or by any means, electronic, mechanical, photocopying, recording or otherwise, or stored in any retrieval system of any nature without the permission of cracku.in, application for which shall be made to support@cracku.in

Downloaded from cracku.in

SSC CHSL 3rd June 2022 Shift-2

English Language

1. **The following sentence has been split into four segments. Identify the segment that contains an INCORRECTLY spelt word**
   Subsequent to the delegation's visit to the villages, / a new working commitee and a task force / have been formed to carry out / all the developmental works as promised to the people.

A a new working commitee and a task force

B all the developmental works as promised to the people

C have been formed to carry out

D Subsequent to the delegation's visit to the villages

Answer: A

2. **Select the most appropriate synonym of the highlighted word.**
   The moral values in this nation were at their nadir during the autocrat's rule.

A base

B peak

C median

D horizon

Answer: A

3. **Select the option that can be used as a one-word substitute for the given group of words.**
   One who loves the company of others

A Gregarious

B Philanthropist

C Patent

D Misanthrope

Answer: A

4. **Select the most appropriate ANTONYM of the given word.**
   Pure

A flawless

B Complex

C Lucid

D Indecent

Answer: D

SSC CHSL Free Mock Test

Downloaded from cracku.in

5. **Select the option that expresses the given sentence in passive voice.**
Please bring me a glass of water.

A Let a glass of water be given to me.

B Let a glass of water being brought to me, please.

C Let a glass of water come to me.

D Let a glass of water be brought to me, please.

Answer: D

6. **Select the most appropriate option to substitute the underline segment in the given sentence.**
The delegates talked of the matter for an hour but without any result.

A talked from

B talked over

C talked above

D talked to

Answer: B

7. **Select the INCORRECTLY spelt word.**

A Appearance

B Controversy

C Definetly

D Characteristic

Answer: C

SSC CHSL Prevoius Papers (DOWNLOAD PDF)

8. **Select the option that will improve the underlined part of the given sentence.**
Sahukaars provide loan in 2% interest rate for a month, which is higher than the bank charges.

A at 2% interest in a month

B at 2% interest rate per month

C for 2% interest rate every month

D for 2% interest for a month

Answer: B

9. **Select the most appropriate meaning of the given idiom.**
By leaps and bounds

A Very quickly

B Very slowly

Downloaded from cracku.in

C Superb catch in a cricket match

D Brisk walk

Answer: A

10. **Sentences of a paragraph are given below in jumbled order. Arrange the sentences in the correct order to form a meaningful and coherent paragraph.**
A. The sharp increase in our consumption of fossil fuels has led to their depletion at an alarming rate.
B. Unchecked burning of fossil fuel is like an unchecked dripping tap which will eventually run dry.
C. The toxic pollutants released from burning these fuels are also a cause for concern.
D. This has led to the tapping of various non-conventional sources of energy that are cleaner alternatives to fossil fuels.

A CBAD

B DCBA

C CDBA

D ACBD

Answer: D

SSC CGL Previous Papers (DOWNLOAD PDF)

11. **Select the most appropriate meaning of the given idiom.**
Under the weather

A Left by a loved one

B Very angry

C Under debt

D Feeling ill

Answer: D

12. **The following sentence has been split into four segments. Identify the segment that contains a grammatical error**
You and I / am going / to make / a great team.

A You and I

B a great team

C am going

D to make

Answer: C

13. **Select the option that will improve the underlined part of the given sentence.**
Reena got embarrassed and started crying.

A frightened and started shouting

B humiliated and started weeping

C frustrated and started yelling

Downloaded from cracku.in

D conscious and started admiring

Answer: B

SSC CGL Free Mock Test (Latest Pattern)

14. **Select the denotation of the highlighted word.**
The divisive politics of this nation has led to its downfall.

A Alienating

B Encouraging

C Dethroning

D Spurring

Answer: A

15. **Select the INCORRECTLY spelt word.**

A Expelled

B Implicate

C Sabotege

D Sartorial

Answer: C

16. **Which word in the given sentence is the ANTONYM of - nibble?**
They sprinted across the floor and leaped up to the elevated platforms, poking their soft muzzles into the stanchions to gobble the grain.

A sprinted

B muzzles

C elevated

D gobble

Answer: D

SSC CHSL Important Questions and Answers (Download PDF)

17. **Select the option that will improve the underlined part of the given sentence.**
I was <u>forbidden to take</u> any drink.

A prohibited from rejecting

B prohibited from rebuffing

C prohibited from receiving

D prohibited from snubbing

Answer: C

Downloaded from cracku.in

18. **Select the most appropriate synonym of the given word.**
Startle

A Surprise

B Impress

C Delight

D Tumble

Answer: A

19. **Select the option that will improve the underlined part of the given sentence.**
We should all stays united.

A are staying

B had staying

C stay

D stayed

Answer: C

SSC CHSL Study Material

20. **Select the option that expresses the given sentence in active voice.**
As was customary, the young prince was brought to the podium in a diamond studded carriage for the coronation ceremony.

A As was customary, the young prince brought in a diamond studded carriage to the podium for the coronation ceremony.

B As was customary, the palace staff brought the young prince to the podium in a diamond studded carriage for the coronation ceremony.

C As was customary, the young prince brings himself to the podium in a diamond studded carriage for the coronation ceremony

D As was customary, the young prince is bought to the podium in a diamond studded carriage for the coronation ceremony.

Answer: B

Instructions [21 - 25]

In the following passage, some words have been deleted. Read the passage carefully and select the most appropriate option to fill in each blank.

Comprehension:
Relate comic things (1)_____ pompous fashion. Irregularity, in other words the unexpected, the surprising, the astonishing, are essential to and characteristic (2)_____ beauty. Two fundamental literary qualities: supernaturalism and irony. The blend (3)_____ the grotesque and the tragic are attractive to the mind, as is discord to blase ears. Imagine a canvas for a lyrical, magical farce, for a pantomime, and translate it (4) _____ a serious novel. Drown the whole thing in an abnormal, (5) _____ atmosphere, in the atmosphere of great days - the region of pure poetry.

21. **Select the most appropriate option to fill in blank number 1.**

A in

Downloaded from cracku.in

B off

C at

D over

Answer: A

22. **Select the most appropriate option to fill in blank number 2.**

A in

B by

C at

D of

Answer: D

SSC CHSL Free App

23. **Select the most appropriate option to fill in blank number 3.**

A to

B on

C of

D up

Answer: C

24. **Select the most appropriate option to fill in blank number 4.**

A beside

B off

C into

D for

Answer: C

25. **Select the most appropriate option to fill in blank number 5.**

A hygienic

B plentiful

C dreamy

D littered

Answer: C

Daily Free SSC Practice Set

Downloaded from cracku.in

26. **If 'A' denotes '+', 'B' denotes '×', 'C' denotes '−' and 'D' denotes '÷', then what will come in place of '?' in the following equation?**
21 A 34 C 6 B (72 D 9) A 13 B 1 + (56 D 4) = ?

A 43

B 35

C 34

D 29

Answer: C

Free SSC Study Material (18,000 Solved Questions)

27. **Select the option that is related to the third term in the same way as the second term is related to the first term and the sixth term is related to the fifth term.**
13 : 78 :: 23 : ? :: 19 : 228

A 276

B 368

C 298

D 342

Answer: B

28. **Three statements are given, followed by three conclusions numbered I, II and III. Assuming the statements to be true, even if they seem to be at variance with commonly known facts, decide which of the conclusions logically follow(s) from the statements.**
Statements:
Some strawberries are bananas.
All bananas are avocados.
Some avocados are grapes.
Conclusion:
I. Some avocados are bananas.
II. Some grapes are bananas.
III. Some avocados are strawberries.

A Only conclusions I and III follow

B Only conclusion II follows

C Only conclusions I and II follow

D Only conclusion I follows

Answer: A

29. **Which of the following numbers will replace the question mark (?) in the given series?**
57, 62, 45, ?, 33, 86

A 52

Downloaded from cracku.in

B 70

C 62

D 74

Answer: D

1500+ Very Important Free SSC Solved Questions

30. **Select the set in which the numbers are related in the same way as are the numbers of the following set.**
(50, 10, 15)
(60, 10, 16)
(NOTE : Operations should be performed on the whole numbers, without breaking down the numbers into its constituent digits. E.g. 13 - Operations on 13 such as adding /deleting /multiplying etc. to 13 can be performed. Breaking down 13 into 1 and 3 and then performing mathematical operations on 1 and 3 is NOT allowed)

A (80, 20, 16)

B (60, 10, 6)

C (60, 15, 19)

D (80, 6, 15)

Answer: C

31. **Two different positions of the same dice are shown, the six faces of which are numbered from 1 to 6. Select the number that will be on the face opposite to the one showing '2'.**

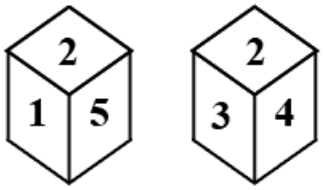

A 4

B 6

C 1

D 3

Answer: B

32. **Each of the seven friends, Misha, Minshu, Mohi, Priya, Veer, Pari and Krishi, has a different height. Krishi is taller than only three people. Pari is taller than only Veer. Misha is taller than Minshu but not Mohi. Priya is taller than Mohi.**
Who among the following is taller than Krishi?

A Pari

B Veer

C Minshu

D Mohi

Answer: D

Downloaded from cracku.in

SSC Exam Update Videos & Free Study Material (YouTube Channel)

33. **Select the correct combination of mathematical signs to replace the * signs and to balance the given equation.**
91*13*26*51*18

A $\div, =, +, -$

B $\times, -, =, +$

C $\times, =, -, -$

D $\div, +, =, -$

Answer: D

34. **Select the option that represents the correct order of the given words as they would appear in an English dictionary.**
1.Proper
2.Pronoun
3.Proof
4.Prophecy
5.Propel

A 2, 3, 5, 1, 4

B 2, 1, 5, 3, 4

C 2, 1, 3, 5, 4

D 2, 3, 1, 5, 4

Answer: A

35. **In a certain code language, 'BROWSER' is written as 'DTQYUGT' and 'MONITOR' is written as 'OQPKVQT'. How will 'PRINTER' be written in that language?**

A RTKPVGT

B RTKLVGT

C RTKPVHT

D RTKPUGT

Answer: A

Latest Job Updates on Telegram - Join here

36. **In a certain code language, 'PAIR' is written as 'ZKIR' and 'SAIL' is written as 'ZHOR'. How will 'BULK' be written in that language?**

A FPOY

B FYPO

C OPYF

D YFPO

Answer: B

Downloaded from cracku.in

37. **Which of the following numbers will replace the question mark (?) in the given series?**
16, 96, 101, ?, 407, 814

A 396

B 405

C 404

D 400

Answer: C

38. **Which of the following numbers will replace the question mark (?) in the given series?**
23, 22, 26, 17, 33, 8, ?

A 38

B 36

C 40

D 44

Answer: D

Join SSC Daily Quiz Telegram Group

39. **Select the option figure which is embedded in the given figure as its part (rotation is NOT allowed).**

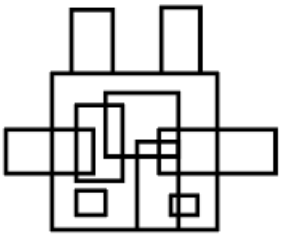

A 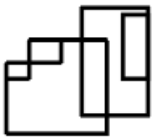

B 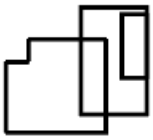

C 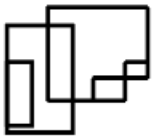

D 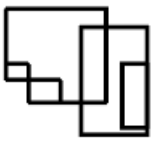

Answer: C

Downloaded from cracku.in

40. **Select the correct mirror image of the given combination when the mirror is placed at MN as shown.**

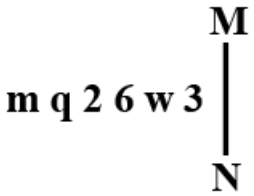

A 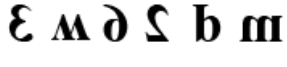

B 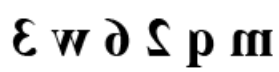

C 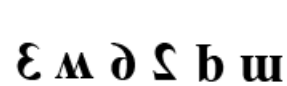

D 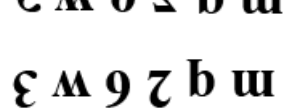

Answer: B

41. **Select the option that represents the letters that, when placed from left to right in the blanks, will complete the letter series.**
_ V E F I B V _ F I C V E F _ D _ E F _

A A E I V I

B E I V I A

C A I E V I

D E I V A I

Answer: A

42. **Select the option that is related to the fifth term in the same way as the second term is related to the first term and fourth term related to third term.**
12:1764 :: 8:528 :: 16:?

A 4156

B 4266

C 4160

D 4260

Answer: C

43. **Select the option that represents the letters that, when sequentially placed from left to right in the blanks below, will complete the letter series.**
K a _ _ N _ a K _ R a _ K a _a R _ N K a

A K a K a N K a

B R a K a N K a

C R a R a N K a

D R a K a N R a

Downloaded from cracku.in

Answer: B

44. **Study the given pattern carefully and select the number that can replace the question mark (?) in it.**
First row:54, 72, 90
Second row: 79, 97, 115
Third row:83, 101, ?
(NOTE: Operations should be performed on the whole numbers, without breaking down the number into its constituent digits. For example, 13 - Operations on 13 such as adding/deleting/multiplying etc. to 13 can be performed. Breaking down 13 into 1 and 3 and then performing mathematical operations on 1 and 3 is not allowed.)

A 114

B 119

C 120

D 129

Answer: B

SSC CHSL Free Mock Test

45. **Select the option that is related to the fifth number in the same way as the second number is related to the first number and the fourth number is related to the third number.**
13 : 120 : : 17 : 152 : : 21 : ?

A 188

B 184

C 144

D 148

Answer: B

46. **Select the figure from among the given options that can replace the question mark(?) in the following series.**

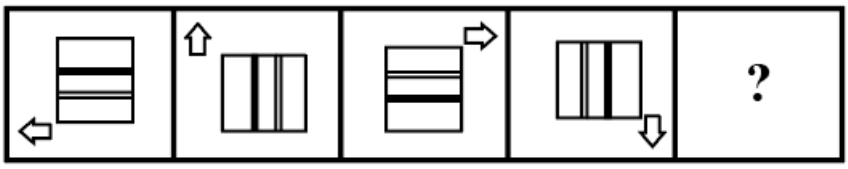

A

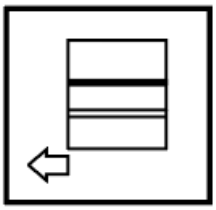

B

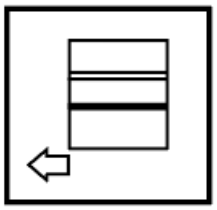

Downloaded from cracku.in

C 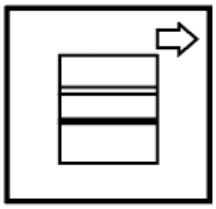

D 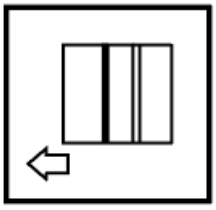

Answer: A

47. **Select the option that is related to the fifth term in the same way as the second term is related to the first term and the fourth term is related to the third term.**
BURGER : UBTIRE :: EDITOR : DEKVRO :: PLASMA : ?

A LPCUAM

B PLSAMA

C PLHZMA

D LPSAAM

Answer: A

SSC CHSL Prevoius Papers (DOWNLOAD PDF)

48. **Select the option figure ,which is embedded in the given figure as its part (rotation is NOT allowed).**

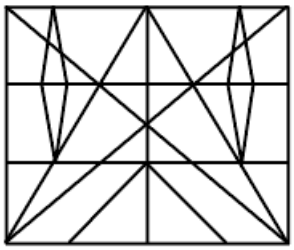

A 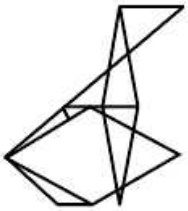

B

C

Downloaded from cracku.in

D 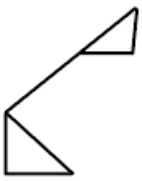

Answer: D

49. **Select the correct mirror image of the given combination when the mirror is placed at XY as shown.**

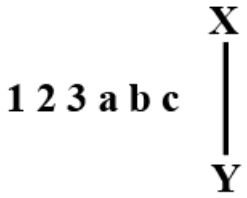

A 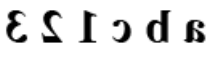

B 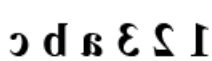

C 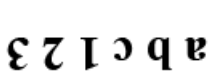

D 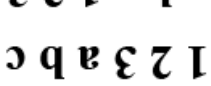

Answer: B

50. **If 25 March 1995 is a Saturday, then what will be the day of the week on 12 December 1997?**

A Friday

B Tuesday

C Thursday

D Saturday

Answer: A

SSC CGL Previous Papers (DOWNLOAD PDF)

Quantitative Aptitude

51. **If a - b =3 and $a^3 - b^3 = 999$, then find the value of $a^2 - b^2$.**

A 64

B 62

C 63

D 60

Answer: C

SSC CGL Free Mock Test (Latest Pattern)

Downloaded from cracku.in

52. **A seller combines 26 kg of rice priced at ₹20 per kg with 30 kg of rice priced at ₹36 per kg and sells the mixture for ₹30 per kg. What is the percentage of profit he makes?**

A 8

B 3

C 5

D 7

Answer: C

53. **A man offers a 21% discount on an item. He offers a further discount of 40% on the reduced price for the first 100 customers. If the selling price of the item is ₹4,740, and the customer is one of the frist 100 then the marked price (in ₹) of the item is**

A ₹12,000

B ₹8,000

C ₹9,000

D ₹10,000

Answer: D

54. **Which of the following numbers is NOT divisible by 36?**

A 136216

B 124344

C 259884

D 120816

Answer: A

SSC CHSL Important Questions and Answers (Download PDF)

55. **Find the volume of a solid hemisphere whose radius is 6.3 cm.(Use $\pi = \frac{22}{7}$)**

A 623.908 cm^3

B 823.908 cm^3

C 523.908 cm^3

D 723.908 cm^3

Answer: C

56. **In one-sixth of the time that B takes to complete a piece of work, A can complete half of the same work. If working together they take 16 days to complete the work, how much time shall B take to complete it alone?**

A 44 days

B 76 days

Downloaded from cracku.in

C 38 days

D 64 days

Answer: D

57. **If** $1+\tan\theta=\sqrt{3}$, **then** $\sqrt{3}\cot\theta-1=$ _____

A $\frac{\sqrt{3}+1}{2}$

B $\frac{2\sqrt{3}-1}{2}$

C $\frac{\sqrt{3}-1}{2}$

D $\frac{2\sqrt{3}+1}{2}$

Answer: A

SSC CHSL Study Material

58. **The price of an article is reduced by 30% but the daily sale of the article increased by 35%. The net percentage effect on the daily sale receipts is:**

A $5\frac{1}{2}\%$ increase

B $6\frac{1}{2}\%$ increase

C $5\frac{1}{2}\%$ decrease

D $6\frac{1}{2}\%$ decrease

Answer: C

59. **The value of** $52-5[2+32-2(5-3)+5-10]\div 8$ **is:**

A 41.315

B 51.375

C 40.375

D 50.375

Answer: B

60. **A dealer had 120 kg of wheat. A part of it was sold by him at 10% gain and the rest at 25% gain. overall, he had a gain of 15%. How much of the wheat was sold at 10% gain?**

A 50 kg

B 40 kg

C 60 kg

D 80 kg

Answer: D

Downloaded from cracku.in

61. The given pie chart shows the percentage wise distribution of books in 5 different states A, B, C, D and E. The total number of books is 2500.

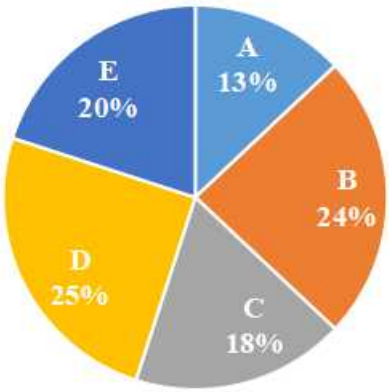

What is the difference between the total number of books in states B and C together and the total number of books in states D and E together?

A 25

B 50

C 75

D 43

Answer: C

62. The area of a square is $4x^2 - 12x + 9$. Which of the following will be the side of the square?

A (3x + 2)

B (2x - 3)

C (2x + 3)

D (3x - 2)

Answer: B

63. If we want ₹8,640 three years from now and the compounded interest rate is 20% p.a how much should we invest today? (assuming interest is compounded yearly)

A ₹4,500

B ₹5,000

C ₹6,000

D ₹5,500

Answer: B

Daily Free SSC Practice Set

64. In a 1500-m race, if A beats B by 100 m and B beats C by 150 m, then by what distance (in m) does A beat C?

Downloaded from cracku.in

A 150

B 240

C 140

D 100

Answer: B

65. **What is the radius of a sphere having volume of 4851 cm^3 ? (Use $\pi = \frac{22}{7}$)**

A 10.5 cm

B 12.5 cm

C 9.5 cm

D 11.5 cm

Answer: A

66. **With an average speed of 60 km/h, a train reaches its destination on time. If it goes with an average speed of 45 km/h, it is late by 20 minutes. The distance covered by the train is _____.**

A 40 km

B 30 km

C 60 km

D 50 km

Answer: C

Free SSC Study Material (18,000 Solved Questions)

67. **If $a + b + c = 0$, then find the value of $\frac{a^2+b^2+c^2}{a^2-bc}$.**

A -1

B 1

C -2

D 2

Answer: D

68. **PQ and RS are two parallel chords of a circle of length 10 cm and 24 cm, respectively, and lie on the same side of the centre O. If the distance between the chords is 7 cm, what is the radius (in cm) of the circle?**

A 7

B 13

C 11

Downloaded from cracku.in

D 9

Answer: B

69. **A dealer purchased a food processor for ₹10,000. He offered a discount of 20% on its listed price and still gained a profit of 40%. Find the listed price of the food processor.**

A ₹17,500

B ₹16,000

C ₹12,000

D ₹15,200

Answer: A

1500+ Very Important Free SSC Solved Questions

70. **Study the given pie-chart and answer the question that follows.**
The pie-chart below represents the actual number of students securing different grades in a science test.

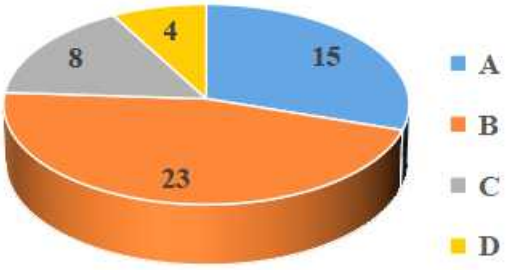

Calculate the percentage of students who took the test and secured a D grade.

A 2

B 16

C 4

D 8

Answer: D

71. **The surface area of a solid metallic sphere is 616 cm2. It is melted and recast into a solid cone of height 28 cm. Find the diameter of the base of the cone so formed. (Take $\pi = \frac{22}{7}$)**

A 12 cm

B 10 cm

C 14 cm

D 16 cm

Answer: C

72. **Find the third proportional to 27 and 18.**

A 36

Downloaded from cracku.in

B 12

C 48

D 9

Answer: B

SSC Exam Update Videos & Free Study Material (YouTube Channel)

73. **Raman has a certain average after 9 innings. In the 10th inning he scores 100 runs, thereby increasing his average by 8 runs. His new average is _____.**

A 24

B 28

C 20

D 22

Answer: B

74. **In an election between two candidates, a candidate who gets 72% of votes is elected by a majority of 572 votes. Find the total number of the votes polled. (assuming all votes are valid)**

A 1300

B 900

C 1500

D 1100

Answer: A

75. **The following table shows the production of five. types of cars by a company for the years 2012 to 2015.**

Years → / Types of cars ↓	2012	2013	2014	2015	Total
D1	7	21	17	6	51
D2	15	11	15	14	55
D3	20	15	12	13	60
D4	5	8	9	25	47
D5	19	15	18	15	67
Total	66	70	71	73	280

In which year was the total production of cars of types D2 and D3 taken together, equal to the total production of cars of types D4 and D5 taken together?

A 2013

B 2014

C 2012

D 2015

Answer: B

Downloaded from cracku.in

Latest Job Updates on Telegram - Join here

General Awareness

76. **Which of the following is used as a pesticide or fumigant for cereals and as an igniting agent in flares?**

A Magnesium bisulphite

B Aluminium phosphide

C Hydrogen peroxide

D Ethanoic acid

Answer: B

Join SSC Daily Quiz Telegram Group

77. **Identify the factor that does NOT affect the salinity of the ocean.**

A The amount of fresh water flowing into the ocean

B Wind

C The type of marine organisms found in the water bodies

D The rate of evaporation and precipitation

Answer: C

78. **Who among the following won the Best Male Singer National Award at the 67th National Film Awards?**

A B Praak

B Mika Singh

C K.J Yesudas

D Arijit Singh

Answer: A

79. **Which of the following teams was defeated by the Indian Hockey team to win the bronze medal in Asian Champions Trophy 2021 on December 22, 2021?**

A Bangladesh

B Pakistan

C Sri Lanka

D Nepal

Answer: B

80. **Who among the following became the youngest player to defeat world number one chess champion, Magnus Carlsen, of Norway in an online chess tournament in February 2021?**

Downloaded from cracku.in

A Abhijeet Gupta

B Rameshbabu Praggnanandhaa

C Nihal Sarin

D Vidit Gujrathi

Answer: B

81. **The Novel 'Train to Pakistan' dealing with the tragedy of India's Partition is written by whom among the following authors?**

A Khushwant Singh

B Ruskin Bond

C Mulk Raj Anand

D M L Malgaonkar

Answer: A

82. **As per coding convention of India Census, how many digit code is used for showing state code?**

A 3

B 1

C 4

D 2

Answer: D

SSC CHSL Free Mock Test

83. **Rama Vaidyanathan was awarded with the honour of the Devadasi National Award in 2013 for her contribution in which of the following Indian dance forms?**

A Mohiniyattam

B Bharatnatyam

C Kuchipudi

D Odissi

Answer: B

84. **Kamalini Asthana and Nalini Asthana, the celebrated dancer duo have been conferred the Padma Shri for their significant contribution to which of the following dance forms in 2022?**

A Kathak

B Bharatanatyam

C Kathakali

D Manipuri

Downloaded from cracku.in

Answer: A

85. **Who among the following has been awarded the Padma Shri in 2020 for her contribution in Indian Classical dance?**

A Shovana Narayan

B Rukmini Devi Arundale

C Padma Subrahmanyam

D Indira PP Bora

Answer: D

SSC CHSL Prevoius Papers (DOWNLOAD PDF)

86. **What is the role of ribosomes of a polysome?**

A Help in DNA replication

B Translate the mRNA into proteins

C Create rRNA

D Help in making DNA

Answer: B

87. **The systematic name of which compound is nitrogen trihydride that is widely used in many industrial processes, and as a fertiliser and refrigerant?**

A Ammonia

B Potash

C Urea

D Phosphine

Answer: A

88. **Who synthesised acetic acid for the first time?**

A Berzelius

B Kolbe

C F Wohler

D Berthelot

Answer: B

SSC CGL Previous Papers (DOWNLOAD PDF)

89. **How many countries share the natural heritage of the Caspian Sea?**

A Four

Downloaded from cracku.in

B Two

C Five

D Three

Answer: C

90. **Famous singer Teejan Bai is related to which of the following folk musics?**

A Pandvani

B Aalha

C Mand

D Pabuji ki Phad

Answer: A

91. **To combat inflation, what is the usual monetary policy stance adopted?**

A Hawkish

B Hicksian

C Dovish

D Owlish

Answer: A

SSC CGL Free Mock Test (Latest Pattern)

92. **In which sport is the term LONA used?**

A Kabaddi

B Volleyball

C Kho-Kho

D Soft ball

Answer: A

93. **Autobiography of an Unknown Indian is the collective memoir of _____.**

A Amitav Ghosh

B Vikram Seth

C Nirad C Chaudhuri

D Salman Rushdie

Answer: C

94. **The "Sattriya" classical dance is associated with which state?**

Downloaded from cracku.in

A Odisha

B Assam

C Bihar

D Kerala

Answer: B

SSC CHSL Important Questions and Answers (Download PDF)

95. **Who among the following is NOT a recipient of Bharat Ratna Award?**

A Pandit Ravi Shankar

B Bhimsen Joshi

C Bismillah Khan

D Pandit Kumar Gandharva

Answer: D

96. **In February 2022, the Karnataka High Court declared certain provisions of the Karnataka Police (Amendment) Act, 2021 as unconstitutional, which prohibited and criminalised the activities related to _____.**

A use of dark web

B gambling

C online gaming

D gathering at nightclubs

Answer: C

97. **Which of the following novel is written by Bhisham Sahni?**

A Nirmala

B Tamas

C Gunahon Ka Devta

D Vande Mataram

Answer: B

SSC CHSL Study Material

98. **Who among the following described the Indian Constitution as 'quasi federal'?**

A AV Dicey

B MV Pylee

C KC Wheare

Downloaded from cracku.in

D Gunnar Myrdal

Answer: C

99. **What is the maximum number of players of a single team on the floor at one time in a basketball game?**

A 6

B 7

C 5

D 4

Answer: C

100. **Allah Jilai Bai, a singer from Rajasthan is famous for which of the following?**

A Ghazals

B Hindustani classical vocals

C Folk songs

D Bhajans

Answer: C

SSC CHSL Free App

SSC CHSL Free Mock Test

SSC CHSL Prevoius Papers (DOWNLOAD PDF)

SSC CGL Previous Papers (DOWNLOAD PDF)

SSC CGL Free Mock Test (Latest Pattern)

SSC CHSL Important Questions and Answers (Download PDF)

SSC CHSL Study Material

SSC CHSL Free App

Daily Free SSC Practice Set

Free SSC Study Material (18,000 Solved Questions)

Downloaded from cracku.in

1500+ Very Important Free SSC Solved Questions

SSC Exam Update Videos & Free Study Material (YouTube Channel)

Latest Job Updates on Telegram - Join here

Join SSC Daily Quiz Telegram Group

Downloaded from cracku.in